INTERVAL QUALITY Name: _____

* Remember an interval is the distance between two notes including those two notes*

Draw the note that completes the given interval.



Intervals also have a quality, which is based off of the key signature of the bottom pitch.

~~If no notes are changed outside of the key sig (no extra #s or bs directly next to the top note)~~

the following rules apply: P: 1458 M: 2367

* Identify the size and quality of the following intervals.



_____ _____ _____ _____ _____

P= PERFECT M= MAJOR When ID'ing, put quality then size.

Complete the following intervals:

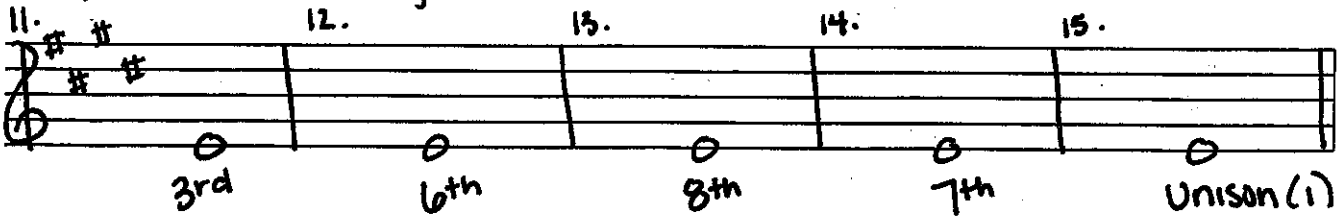



NOTES:

~~A tempo - go back to the original tempo~~

~~Accelerando - gradually get faster~~